OMG-OCUP2-INT200 Q&As

OMG Certified UML Professional 2 (OCUP 2) - Intermediate Level

Pass OMG OMG-OCUP2-INT200 Exam with 100% Guarantee

Free Download Real Questions & Answers **PDF** and **VCE** file from:

https://www.passapply.com/omg-ocup2-int200.html

100% Passing Guarantee
100% Money Back Assurance

Following Questions and Answers are all new published by OMG Official Exam Center

Instant Download After Purchase
100% Money Back Guarantee
365 Days Free Update
800,000+ Satisfied Customers

QUESTION 1

What symbol depicts a Call Behavior Action?

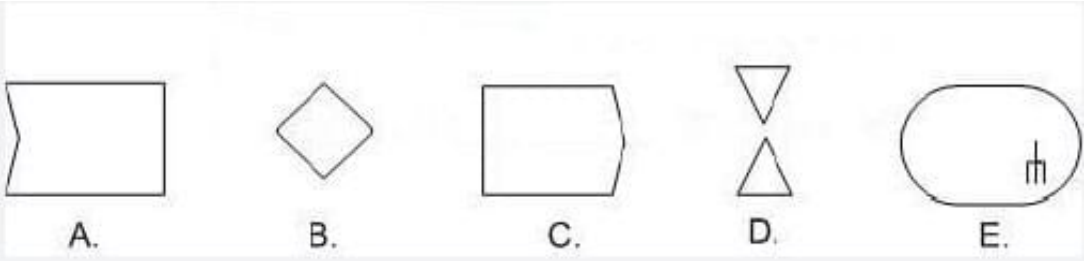

A. A

B. B

C. C

D. D

E. E

Correct Answer: E

QUESTION 2

To what does an internal structure of a class refer?

A. the decomposition of that class in terms of interconnected parts

B. the set of structural features of that class

C. the inheritance structure of that class

D. the set of nested classifiers of that class

E. class and associations owned by that class

Correct Answer: A

QUESTION 3

In the exhibit, how many of the arrows must provide values for the outgoing arrow to be given a value?

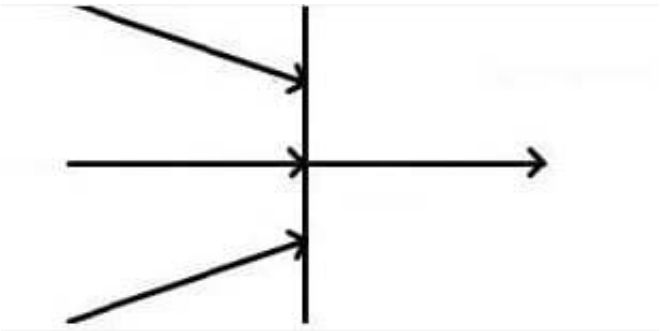

A. none

B. three

C. one

D. two

Correct Answer: B

QUESTION 4

What kind of element is a central buffer?

A. object node

B. control node

C. action

D. behavior

E. activity

F. state

Correct Answer: A

QUESTION 5

In the exhibit, if the incoming arrows provide one control value and two data values, what values are provided to the outgoing arrows?

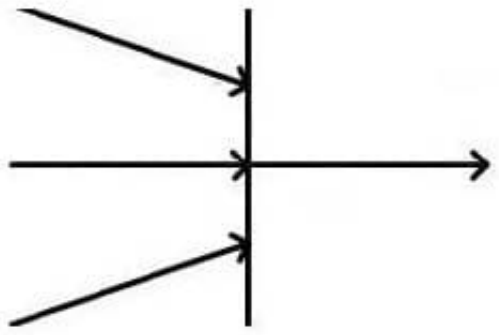

A. the two data values

B. a single control value

C. a single data value combining the original two data values

D. both the control and two data values

Correct Answer: A

Latest OMG-OCUP2-INT200 Dumps | OMG-OCUP2-INT200 PDF Dumps | OMG-OCUP2-INT200 VCE Dumps